SSC CHSL
Tier-II

Previous Year Paper
18 Nov, 2024

Adda247

Test Prime

ALL EXAMS, ONE SUBSCRIPTION

1,00,000+ Mock Tests

Personalised Report Card

Unlimited Re-Attempt

600+ Exam Covered

25,000+ Previous Year Papers

500% Refund

IBPS · NABARD · INDIAN RAILWAYS

ATTEMPT FREE MOCK NOW

Combined Higher Secondary Level Examination 2024 Tier II

Roll Number	
Candidate Name	
Venue Name	
Exam Date	18/11/2024
Exam Time	9:00 AM - 12:00 PM
Subject	CHSL 2024 Tier II

Section : **Module I Mathematical Abilities**

Q.1	**The weights (in kg) of 7 cousins in a family are 54, 62, 65, 70, 60, 59, 55.** **Find the median weight.**
Ans	✔ 1. 60 kg
	✘ 2. 61.5 kg
	✘ 3. 70 kg
	✘ 4. 61 kg

Question ID :	**630680544798**
Option 1 ID :	**6306802129957**
Option 2 ID :	**6306802129956**
Option 3 ID :	**6306802129954**
Option 4 ID :	**6306802129955**
Status :	**Answered**
Chosen Option :	**1**

Q.2	**If 88 is replaced by 93 and 41 is replaced by 47 in the following observations, 46, 48, 63, 76, 88, 41, 35, 55, 90, 56, 92, then what would be the difference between the new median and the previous median?**
Ans	✘ 1. 3
	✘ 2. 1
	✘ 3. 2
	✔ 4. 0

Question ID :	**630680354924**
Option 1 ID :	**6306801381772**
Option 2 ID :	**6306801381770**
Option 3 ID :	**6306801381771**
Option 4 ID :	**6306801381769**
Status :	**Answered**
Chosen Option :	**4**

Q.3	The value of $5+24\times8\div8$ of $8-8\div8\times4$ of 4 is equal to:
Ans	✗ 1. 8
	✗ 2. 9
	✗ 3. −9
	✓ 4. −8

Question ID :	**630680543677**
Option 1 ID :	**6306802125510**
Option 2 ID :	**6306802125511**
Option 3 ID :	**6306802125512**
Option 4 ID :	**6306802125509**
Status :	**Answered**
Chosen Option :	**4**

Q.4	Sandeep made a profit of 22% when he sold an overcoat for ₹8,540. Find the cost price of the overcoat.
Ans	✓ 1. ₹7,000
	✗ 2. ₹6,000
	✗ 3. ₹6,500
	✗ 4. ₹7,500

Question ID :	**630680531164**
Option 1 ID :	**6306802076471**
Option 2 ID :	**6306802076469**
Option 3 ID :	**6306802076470**
Option 4 ID :	**6306802076472**
Status :	**Answered**
Chosen Option :	**1**

Q.5	A sum on simple interest at the rate of 5% per annum amounts to ₹4,160 in 6 years. Find the sum.
Ans	✗ 1. ₹2,900
	✗ 2. ₹3,100
	✗ 3. ₹2,800
	✓ 4. ₹3,200

Question ID :	**630680116185**
Option 1 ID :	**630680450072**
Option 2 ID :	**630680450070**
Option 3 ID :	**630680450073**
Option 4 ID :	**630680450071**
Status :	**Answered**
Chosen Option :	**4**

Q.6	Simplify $(2z - 5y)^2 + (5z + 2y)^2 - 25z^2$.
Ans	✔ 1. $29y^2 + 4z^2$
	✘ 2. $29y^2 - 4z^2$
	✘ 3. $19y^2 - 4z^2$
	✘ 4. $19y^2 + 4z^2$

Question ID :	**630680768734**
Option 1 ID :	**6306803012913**
Option 2 ID :	**6306803012914**
Option 3 ID :	**6306803012915**
Option 4 ID :	**6306803012912**
Status :	**Answered**
Chosen Option :	**1**

Q.7	Find the value of $3(\sec^2 A - 1)(\text{cosec} A - 1)(\text{cosec} A + 1) + 4(\text{cosec}^2 A - \cot^2 A)$.
Ans	✔ 1. 7
	✘ 2. 3
	✘ 3. 12
	✘ 4. 10

Question ID :	**630680530975**
Option 1 ID :	**6306802075714**
Option 2 ID :	**6306802075713**
Option 3 ID :	**6306802075716**
Option 4 ID :	**6306802075715**
Status :	**Answered**
Chosen Option :	**1**

Q.8	**The price of an electronic machine decreased by 5%, 10% and 15% during the first three years. What will be the price of the machine after three years if the value at the beginning was ₹ 8,000?**
Ans	✔ 1. ₹ 5,814
	✘ 2. ₹ 5,000
	✘ 3. ₹ 6,721
	✘ 4. ₹ 7,000

Question ID :	**630680769067**
Option 1 ID :	**6306803014286**
Option 2 ID :	**6306803014284**
Option 3 ID :	**6306803014287**
Option 4 ID :	**6306803014285**
Status :	**Answered**
Chosen Option :	**1**

Q.9	In a triangle PQR, incentre is A and ∠QAR = 116°. Find the measure of ∠QPR.
Ans	✗ 1. 27°
	✗ 2. 54°
	✗ 3. 26°
	✓ 4. 52°

Question ID :	**630680354948**
Option 1 ID :	**6306801381867**
Option 2 ID :	**6306801381868**
Option 3 ID :	**6306801381865**
Option 4 ID :	**6306801381866**
Status :	**Answered**
Chosen Option :	**4**

Q.10	The average of five integers is 48. The average of the first four integers is 50% of the 5th integer. The 5th integer is:
Ans	✗ 1. 82
	✗ 2. 78
	✗ 3. 74
	✓ 4. 80

Question ID :	**630680103705**
Option 1 ID :	**630680403054**
Option 2 ID :	**630680403052**
Option 3 ID :	**630680403051**
Option 4 ID :	**630680403053**
Status :	**Answered**
Chosen Option :	**4**

Q.11	A milk vendor has 75 litres of cow milk, 45 litres of toned milk and 30 litres of full cream milk. These should be placed in different trays such that each tray contains the same quantity of milk and two kinds of milk should not be mixed in a tray. What is the least number of trays required to place all the milk?
Ans	✗ 1. 20
	✗ 2. 15
	✓ 3. 10
	✗ 4. 25

Question ID :	**630680769069**
Option 1 ID :	**6306803014294**
Option 2 ID :	**6306803014292**
Option 3 ID :	**6306803014293**
Option 4 ID :	**6306803014295**
Status :	**Answered**
Chosen Option :	**3**

Q.12	Ratnesh and Vineet worked on alternate days, starting with Ratnesh. The entire work got completed in $54\frac{3}{4}$ days. If Ratnesh alone can finish the work in 48 days, then in how many days can Vineet alone do the work?
Ans	✗ 1. 66
	✓ 2. 64
	✗ 3. 60
	✗ 4. 62

Question ID :	**630680216708**
Option 1 ID :	**630680840798**
Option 2 ID :	**630680840797**
Option 3 ID :	**630680840795**
Option 4 ID :	**630680840796**
Status :	**Answered**
Chosen Option :	**2**

Q.13	**ABCD is a trapezium in which AB is parallel to CD, and E and F are the mid-points of non-parallel sides AD and BC. If EF is parallel to AB, AB = 28 cm and CD = 18 cm, then find EF (in cm).**
Ans	✗ 1. 5
	✗ 2. 10
	✓ 3. 23
	✗ 4. 46

Question ID :	**630680354945**
Option 1 ID :	**6306801381855**
Option 2 ID :	**6306801381854**
Option 3 ID :	**6306801381856**
Option 4 ID :	**6306801381853**
Status :	**Answered**
Chosen Option :	**3**

Q.14	Find the value of $(\sin^6 A + \cos^6 A + 3\sin^2 A\cos^2 A) - (\sin^4 A - \cos^4 A + 1)\operatorname{cosec}^2 A$.
Ans	✗ 1. 3
	✗ 2. −3
	✗ 3. 0
	✓ 4. −1

Question ID :	**630680531000**
Option 1 ID :	**6306802075816**
Option 2 ID :	**6306802075813**
Option 3 ID :	**6306802075815**
Option 4 ID :	**6306802075814**
Status :	**Answered**
Chosen Option :	**4**

Q.15	If an increase of 40% is observed on an amount in 4 years at simple interest, what will be the compound interest on ₹80,000 after 4 years at the same rate of interest?
Ans	✗ 1. ₹17,128
	✓ 2. ₹37,128
	✗ 3. ₹39,724
	✗ 4. ₹29,728

Question ID :	630680285387
Option 1 ID :	6306801109526
Option 2 ID :	6306801109523
Option 3 ID :	6306801109525
Option 4 ID :	6306801109524
Status :	Answered
Chosen Option :	2

Q.16	A cylinder has a radius of $\frac{8}{\pi}$ cm and its volume is 448 cm^3. What is the height of the cylinder (take $\pi = \frac{22}{7}$)?
Ans	✗ 1. 24 cm
	✓ 2. 22 cm
	✗ 3. 21 cm
	✗ 4. 23 cm

Question ID :	63068056825
Option 1 ID :	630680219230
Option 2 ID :	630680219232
Option 3 ID :	630680219233
Option 4 ID :	630680219231
Status :	Answered
Chosen Option :	2

Q.17	A number 37 is divided into two parts such that 5 times one part and 11 times the other is together equal to 227. Find the value of 9 times the smaller number.
Ans	✓ 1. 63
	✗ 2. 61
	✗ 3. 62
	✗ 4. 60

Question ID :	630680531012
Option 1 ID :	6306802075857
Option 2 ID :	6306802075859
Option 3 ID :	6306802075858
Option 4 ID :	6306802075860
Status :	Answered
Chosen Option :	1

Q.18	For making a toy, a hemisphere is attached at one end of a cylinder and a cone is attached at the other end of the cylinder. The cylinder, the cone and the hemisphere have a common radius of 4.2 cm. The height of the cylinder and that of the cone is 7 cm. Find the volume (in cm^3) of the toy. $\left(\text{Use } \pi = \frac{22}{7}\right)$
Ans	✗ 1. 762.255
	✗ 2. 863.25
	✓ 3. 672.672
	✗ 4. 358.8

Question ID :	**630680285428**
Option 1 ID :	**6306801109679**
Option 2 ID :	**6306801109681**
Option 3 ID :	**6306801109682**
Option 4 ID :	**6306801109680**
Status :	**Answered**
Chosen Option :	**3**

Q.19	**The average of 11 results is 60 and that of the first 10 is 59. The 11th result is?**
Ans	✓ 1. 70
	✗ 2. 60
	✗ 3. 69
	✗ 4. 59

Question ID :	**630680657248**
Option 1 ID :	**6306802572934**
Option 2 ID :	**6306802572935**
Option 3 ID :	**6306802572937**
Option 4 ID :	**6306802572936**
Status :	**Answered**
Chosen Option :	**1**

Q.20	**The surface area of a cube is 1728 cm^2. Find its volume.**
Ans	✗ 1. $4356\sqrt{2}\ cm^3$
	✗ 2. $5436\sqrt{2}\ cm^3$
	✗ 3. $6453\sqrt{2}\ cm^3$
	✓ 4. $3456\sqrt{2}\ cm^3$

Question ID :	**630680531604**
Option 1 ID :	**6306802078209**
Option 2 ID :	**6306802078210**
Option 3 ID :	**6306802078212**
Option 4 ID :	**6306802078211**
Status :	**Answered**
Chosen Option :	**4**

Q.21	Tarun gives Hari a head-start of 60 seconds in a 2400 m race and still beats him by 40 seconds. If the speed of Hari is 6 m/s, find the speed of Tarun.
Ans	✗ 1. 7 m/s
	✗ 2. 8.5 m/s
	✗ 3. 7.5 m/s
	✓ 4. 8 m/s

Question ID :	**630680553718**
Option 1 ID :	**6306802164767**
Option 2 ID :	**6306802164770**
Option 3 ID :	**6306802164768**
Option 4 ID :	**6306802164769**
Status :	**Answered**
Chosen Option :	**1**

Q.22	The average of 11 results is 59 and that of the first 10 is 58. The 11th result is?
Ans	✗ 1. 59
	✗ 2. 58
	✗ 3. 68
	✓ 4. 69

Question ID :	**630680657247**
Option 1 ID :	**6306802572931**
Option 2 ID :	**6306802572932**
Option 3 ID :	**6306802572933**
Option 4 ID :	**6306802572930**
Status :	**Answered**
Chosen Option :	**4**

Q.23	Three numbers are in the ratio 5 : 7 : 9, and their LCM is 1260. What is the difference between the largest and the smallest number?
Ans	✗ 1. 20
	✓ 2. 16
	✗ 3. 24
	✗ 4. 32

Question ID :	**630680468820**
Option 1 ID :	**6306801831060**
Option 2 ID :	**6306801831059**
Option 3 ID :	**6306801831061**
Option 4 ID :	**6306801831062**
Status :	**Answered**
Chosen Option :	**2**

Q.24	A, B and C jointly started a business in which A invested ₹7,000 for 12 months, B invested ₹8,000 for 10 months and C invested ₹12,000 for 6 months. A was the working member for which he received 20% of the profits as his remuneration. The total profit earned at the end of one year was ₹14,750. What is C's share (in ₹) in the profit?
Ans	✗ 1. 4,000
	✓ 2. 3,600
	✗ 3. 4,200
	✗ 4. 2,950

Question ID :	**630680447688**
Option 1 ID :	**6306801748008**
Option 2 ID :	**6306801748007**
Option 3 ID :	**6306801748005**
Option 4 ID :	**6306801748006**
Status :	**Answered**
Chosen Option :	**2**

Q.25	**The radii of the two spheres are in the ratio 4 : 5. Their volume will be in the ratio:**
Ans	✗ 1. 16 : 25
	✗ 2. 125 : 64
	✓ 3. 64 : 125
	✗ 4. 4 : 5

Question ID :	**63068061512**
Option 1 ID :	**630680237406**
Option 2 ID :	**630680237408**
Option 3 ID :	**630680237409**
Option 4 ID :	**630680237407**
Status :	**Answered**
Chosen Option :	**3**

Q.26	**The marked price of an article is ₹2,800. It is sold at three successive discounts of 15%, 8% and 5%. Find the selling price of the article (in ₹).**
Ans	✓ 1. 2,080.12
	✗ 2. 1,890.20
	✗ 3. 1,997.26
	✗ 4. 1,923.56

Question ID :	**630680526249**
Option 1 ID :	**6306802057075**
Option 2 ID :	**6306802057072**
Option 3 ID :	**6306802057074**
Option 4 ID :	**6306802057073**
Status :	**Answered**
Chosen Option :	**1**

Q.27	A die is cast twice and a coin is tossed thrice. Find the probability that the die will turn a 5 each time and the coin will turn a head every time.
Ans	✗ 1. $\frac{1}{100}$
	✓ 2. $\frac{1}{288}$
	✗ 3. $\frac{1}{200}$
	✗ 4. $\frac{1}{50}$

Question ID :	**630680296761**
Option 1 ID :	**6306801154696**
Option 2 ID :	**6306801154697**
Option 3 ID :	**6306801154698**
Option 4 ID :	**6306801154695**
Status :	**Answered**
Chosen Option :	**2**

Q.28	If a man's age is four times the sum of the ages of his three children, and after 6 years his age will be twice the sum of the ages of his three children, then what is the man's present age?
Ans	✓ 1. 60 years
	✗ 2. 45 years
	✗ 3. 56 years
	✗ 4. 30 years

Question ID :	**630680373692**
Option 1 ID :	**6306801456042**
Option 2 ID :	**6306801456040**
Option 3 ID :	**6306801456041**
Option 4 ID :	**6306801456039**
Status :	**Answered**
Chosen Option :	**1**

Q.29	**The numbers of Commerce, Science and Arts postgraduates working in a company are 40, 80 and 60, respectively. If these figures are represented by a pie chart, then what is the angle corresponding to Commerce postgraduates?**
Ans	✗ 1. 50°
	✗ 2. 60°
	✓ 3. 80°
	✗ 4. 70°

Question ID :	**630680373100**
Option 1 ID :	**6306801453671**
Option 2 ID :	**6306801453672**
Option 3 ID :	**6306801453674**
Option 4 ID :	**6306801453673**
Status :	**Answered**
Chosen Option :	**3**

Q.30	**A quadrilateral having equal diagonals and equal opposite sides is always a _____.**
Ans	✓ 1. rectangle
	✗ 2. rhombus
	✗ 3. trapezium
	✗ 4. kite

Question ID :	**630680297308**
Option 1 ID :	**6306801156700**
Option 2 ID :	**6306801156701**
Option 3 ID :	**6306801156702**
Option 4 ID :	**6306801156699**
Status :	**Answered**
Chosen Option :	**1**

Section : **Module II Reasoning and General Intelligence**

Q.1	89 is related to 78 following a certain logic. Following the same logic, 97 is related to 86. To which ofthe following is 72 related, following the same logic? (NOTE: Operations should be performed on the whole numbers, without breaking down the numbers into their constituent digits. E.g. 13 – Operations on 13 such as adding /subtracting /multiplying to 13 can be performed. Breaking down 13 into 1 and 3 and then performing mathematical operations on 1 and 3 is not allowed.)
Ans	✗ 1. 68
	✗ 2. 66
	✓ 3. 61
	✗ 4. 59

Question ID :	**630680555995**
Option 1 ID :	**6306802173359**
Option 2 ID :	**6306802173357**
Option 3 ID :	**6306802173356**
Option 4 ID :	**6306802173358**
Status :	**Answered**
Chosen Option :	**3**

Q.2	In this question, a statement is followed by two conclusions, numbered I and II. Decide which of the two conclusions is/are true based on the given statement. Statement: M < N ≤ O = S > T ≥ W ≥ Z Conclusions: I. M ≤ T II. N < Z
Ans	✗ 1. Both Conclusion I and Conclusion II are true
	✓ 2. Neither Conclusion I nor Conclusion II is true
	✗ 3. Only Conclusion II is true
	✗ 4. Only Conclusion I is true

Question ID :	**630680164120**
Option 1 ID :	**630680635615**
Option 2 ID :	**630680635614**
Option 3 ID :	**630680635613**
Option 4 ID :	**630680635612**
Status :	**Answered**
Chosen Option :	**2**

Q.3	**Select the set in which the numbers are related in the same way as are the numbers of the followingsets.** **(NOTE: Operations should be performed on the whole numbers, without breaking down the numbers into their constituent digits. E.g. 13 – Operations on 13 such as adding /subtracting /multiplying to 13 can be performed. Breaking down 13 into 1 and 3 and then performing mathematical operations on 1 and 3 is not allowed.)** **(19, 9, 173)** **(6, 17, 104)**
Ans	✔ 1. (11, 4, 46)
	✘ 2. (14, 4, 62)
	✘ 3. (8, 12, 94)
	✘ 4. (7, 15, 105)

Question ID :	**630680555989**
Option 1 ID :	**6306802173335**
Option 2 ID :	**6306802173334**
Option 3 ID :	**6306802173332**
Option 4 ID :	**6306802173333**
Status :	**Answered**
Chosen Option :	**1**

Q.4	**If 2 is added to each odd digit and 1 is subtracted from each even digit in the number 23584617, how many digits will appear more than once in the new number thus formed?**
Ans	✔ 1. Three
	✘ 2. None
	✘ 3. Two
	✘ 4. One

Question ID :	**630680375591**
Option 1 ID :	**6306801463522**
Option 2 ID :	**6306801463519**
Option 3 ID :	**6306801463521**
Option 4 ID :	**6306801463520**
Status :	**Answered**
Chosen Option :	**1**

Q.5	Three of the following four number triads are alike in a certain way and thus form a group. Which is the number triad that does not belong to that group? (NOTE: Operations should be performed on the whole numbers, without breaking down the numbers into its constituent digits. E.g. 13 – Operations on 13 such as adding/subtracting/multiplying etc. to 13 can be performed. Breaking down 13 into 1 and 3 and then performing mathematical operations on 1 and 3 is not allowed.)
Ans	✗ 1. 94 - 85 - 76
	✗ 2. 112 - 103 - 94
	✓ 3. 76 - 67 - 54
	✗ 4. 87 - 78 - 69

Question ID :	630680556021
Option 1 ID :	6306802173461
Option 2 ID :	6306802173462
Option 3 ID :	6306802173463
Option 4 ID :	6306802173460
Status :	Answered
Chosen Option :	3

Q.6	Two statements I and II have been given. These statements may be independent causes or effects of independent causes or a common cause. One of the statements maybe the effect of the other statement. Read both the statements and select the correct option. I. All undergraduate exams scheduled for tomorrow in Balasore have been cancelled by the university. New dates will be announced early next week. II. High winds and very heavy rains are expected in Balasore tomorrow as the cyclone makes a landfall by 3 pm.
Ans	✗ 1. I is the cause and II is its possible effect
	✗ 2. Both I and II are independent causes
	✗ 3. Both I and II are effects of independent causes
	✓ 4. II is the cause and I is its possible effect

Question ID :	630680306825
Option 1 ID :	6306801193589
Option 2 ID :	6306801193591
Option 3 ID :	6306801193592
Option 4 ID :	6306801193590
Status :	Answered
Chosen Option :	4

Q.7	**Select the figure from the options that can replace the question mark (?) and complete the given series.**
Ans	✗ 1.
	✗ 2.
	✗ 3.
	✔ 4.

Question ID :	**630680370582**
Option 1 ID :	**6306801443685**
Option 2 ID :	**6306801443682**
Option 3 ID :	**6306801443683**
Option 4 ID :	**6306801443684**
Status :	**Answered**
Chosen Option :	**4**

Q.8	What will come in the place of the question mark (?) in the following equation, if '+' and '−' are interchanged and '×' and '÷' are interchanged? 21 − 7 ÷ 144 × 3 + 18 = ?
Ans	✗ 1. 323
	✗ 2. 330
	✓ 3. 339
	✗ 4. 342

Question ID :	630680375897
Option 1 ID :	6306801464660
Option 2 ID :	6306801464659
Option 3 ID :	6306801464661
Option 4 ID :	6306801464662
Status :	Answered
Chosen Option :	3

Q.9	In a certain code language, 'DARK' is coded as '3284' and 'RAKE' is coded as '6438'.What is the code for 'E' in that language?
Ans	✗ 1. 3
	✓ 2. 6
	✗ 3. 4
	✗ 4. 8

Question ID :	630680557124
Option 1 ID :	6306802177451
Option 2 ID :	6306802177452
Option 3 ID :	6306802177453
Option 4 ID :	6306802177454
Status :	Answered
Chosen Option :	2

Q.10	Select the combination of letters that when sequentially placed in the blanks of the given series, will complete the series. REMRRE_R_EEMRRE_M_
Ans	✗ 1. REME
	✗ 2. EMER
	✓ 3. MREM
	✗ 4. MRME

Question ID :	630680520497
Option 1 ID :	6306802034415
Option 2 ID :	6306802034414
Option 3 ID :	6306802034413
Option 4 ID :	6306802034416
Status :	Answered
Chosen Option :	3

Q.11	How many meaningful English words can be formed from Y, P, R and A, using each letter mandatorily but only once in each word?
Ans	✔ 1. One
	✘ 2. Two
	✘ 3. More than two
	✘ 4. None

Question ID :	630680329064
Option 1 ID :	6306801280094
Option 2 ID :	6306801280095
Option 3 ID :	6306801280096
Option 4 ID :	6306801280093
Status :	Marked For Review
Chosen Option :	1

Q.12	Three of the following word pairs are alike in some manner and hence form a group. Which word pair does not belong to that group? (The words must be considered as meaningful English words and must not be grouped based on the number of letters/number of consonants/vowels in the word.)
Ans	✔ 1. Television - Triangle
	✘ 2. Ring - Circle
	✘ 3. Ball - Sphere
	✘ 4. Birthday hat - Cone

Question ID :	630680557135
Option 1 ID :	6306802177495
Option 2 ID :	6306802177496
Option 3 ID :	6306802177498
Option 4 ID :	6306802177497
Status :	Answered
Chosen Option :	1

Q.13	Which of the following letter-clusters should replace # and % so that the pattern and relationship followed between the letter-cluster pair on the left side of :: is the same as that on the right side of :: ? # : VXB :: ACG : %
Ans	✔ 1. # - UWA, % - BDH
	✘ 2. # - GIM, % - KMQ
	✘ 3. # - HDN, % - BDH
	✘ 4. # - UVN, % - KMQ

Question ID :	630680557129
Option 1 ID :	6306802177471
Option 2 ID :	6306802177472
Option 3 ID :	6306802177473
Option 4 ID :	6306802177474
Status :	Answered
Chosen Option :	1

Q.14	**A certain number of people are sitting in a row facing the north direction. 'T' is sitting to the immediate right of 'U'. 'Y' is sitting 5th to the left of 'U'. 'Z' is an immediate neighbour of both 'T' and 'P'. 'V' is sitting 5th to the left of 'T'. 'O' is sitting at one extreme end, and there is only one person sitting between 'O' and 'Y'. If no other person is sitting in the row, what is the total number of people seated?**
Ans	✔ 1. 11
	✘ 2. 12
	✘ 3. 13
	✘ 4. 14

Question ID :	**630680401308**
Option 1 ID :	**6306801565033**
Option 2 ID :	**6306801565034**
Option 3 ID :	**6306801565035**
Option 4 ID :	**6306801565036**
Status :	**Answered**
Chosen Option :	**1**

Q.15	**Select the option that is related to Figure C in the same way as Figure B is related to Figure A.** 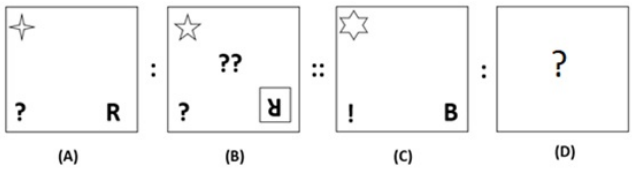 (A) (B) (C) (D)
Ans	✔ 1.
	✘ 2.
	✘ 3.
	✘ 4.

Question ID :	**630680309955**
Option 1 ID :	**6306801205967**
Option 2 ID :	**6306801205968**
Option 3 ID :	**6306801205966**
Option 4 ID :	**6306801205965**
Status :	**Answered**
Chosen Option :	**1**

Q.16	**Select the correct option that indicates the arrangement of the following words in a logical and meaningful order.** **1. Hexagon** **2. Triangle** **3. Pentagon** **4. Square** **5. Octagon**
Ans	✗ 1. 3, 1, 5, 2, 4
	✓ 2. 2, 4, 3, 1, 5
	✗ 3. 2, 1, 3, 4, 5
	✗ 4. 1, 4, 3, 5, 2

Question ID :	**630680567079**
Option 1 ID :	**6306802217279**
Option 2 ID :	**6306802217277**
Option 3 ID :	**6306802217280**
Option 4 ID :	**6306802217278**
Status :	**Answered**
Chosen Option :	**2**

Q.17	**How many meaningful four letter English words can be formed using A, E, D and N using all the letters but each letter only once in each word?**
Ans	✗ 1. 0
	✗ 2. 2
	✓ 3. 1
	✗ 4. 3

Question ID :	**630680615745**
Option 1 ID :	**6306802409650**
Option 2 ID :	**6306802409652**
Option 3 ID :	**6306802409651**
Option 4 ID :	**6306802409653**
Status :	**Answered**
Chosen Option :	**4**

Adda247 GET IT ON Google Play

Q.18 **Select the correct mirror image of the given figure when the mirror is placed at MN as shown below.**

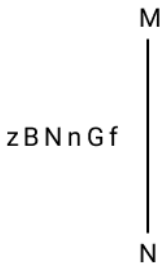

Ans

✗ 1.

✓ 2.

✗ 3. 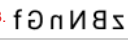

✗ 4.

Question ID :	**630680555733**
Option 1 ID :	**6306802172371**
Option 2 ID :	**6306802172369**
Option 3 ID :	**6306802172368**
Option 4 ID :	**6306802172370**
Status :	**Answered**
Chosen Option :	**2**

Q.19 **Three of the following four number triads are alike in a certain way and thus form a group. Which is the number triad that does not belong to that group?**

(NOTE: Operations should be performed on the whole numbers, without breaking down the numbers into its constituent digits. E.g. 13 – Operations on 13 such as adding/subtracting/multiplying etc. to 13 can be performed. Breaking down 13 into 1 and 3 and then performing mathematical operations on 1 and 3 is not allowed.)

Ans

✗ 1. 29 - 44 - 38

✓ 2. 31 - 46 - 41

✗ 3. 17 - 32 - 26

✗ 4. 24 - 39 - 33

Question ID :	**630680556022**
Option 1 ID :	**6306802173467**
Option 2 ID :	**6306802173465**
Option 3 ID :	**6306802173464**
Option 4 ID :	**6306802173466**
Status :	**Answered**
Chosen Option :	**2**

Q.20	**Read the given statements and conclusions carefully. Assuming that the information given in the statements is true, even if it appears to be at variance with commonly known facts, decide which of the given conclusions logically follow(s) from the statements.** **Statements:** **Some crayon is colour.** **No colour is water.** **Some water is liquid.** **Conclusions:** **I) Some crayon is liquid.** **II) Some crayon is not water.** **III) Some liquid is not colour.**
Ans	✗ 1. Only III
	✗ 2. Only I and III
	✗ 3. Only II
	✓ 4. Only II and III

Question ID :	**630680194947**
Option 1 ID :	**630680756280**
Option 2 ID :	**630680756277**
Option 3 ID :	**630680756279**
Option 4 ID :	**630680756278**
Status :	**Answered**
Chosen Option :	**4**

Q.21	**The sequence of folding a piece of paper and the manner in which the folded paper has been cut is shown below. Select the option figure that would most closely resemble the unfolded form of the paper.** 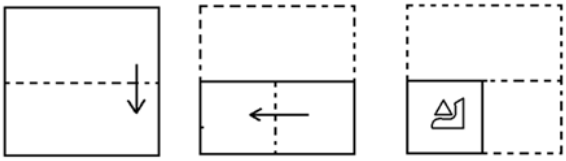
Ans	✗ 1. 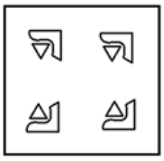
	✓ 2. 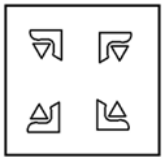
	✗ 3. 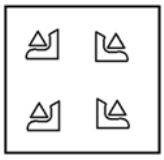
	✗ 4.

Question ID :	**630680468000**
Option 1 ID :	**6306801827904**
Option 2 ID :	**6306801827903**
Option 3 ID :	**6306801827902**
Option 4 ID :	**6306801827905**
Status :	**Answered**
Chosen Option :	**2**

Q.22	**MNQP is related to STWV in a certain way based on the English alphabetical order. In the same way, ABED is related to GHKJ. To which of the following is IJML related, following the same logic?**
Ans	✗ 1. OPRS
	✗ 2. ROPS
	✓ 3. OPSR
	✗ 4. PORS

Question ID :	**63068083300**
Option 1 ID :	**630680323049**
Option 2 ID :	**630680323051**
Option 3 ID :	**630680323048**
Option 4 ID :	**630680323050**
Status :	**Answered**
Chosen Option :	**3**

Q.23	**In this question, a statement is followed by two courses of actions, numbered I and II. You must assume everything in the statement to be true and on the basis of the information given in the statement, decide which of the courses of actions logically follow(s) for pursuing.** **Statement:** **In spite of the principal's repeated warnings, a child was caught with a hidden mobile phone in the school.** **Courses of Action:** **I) The mobile phone should be taken away from the child and the parents should be called to the school.** **II) The child should be punished for committing this mistake.**
Ans	✓ 1. Both (I) and (II) follow
	✗ 2. Neither (I) nor (II) follows
	✗ 3. Only (II) follows
	✗ 4. Only (I) follows

Question ID :	**630680401348**
Option 1 ID :	**6306801565196**
Option 2 ID :	**6306801565195**
Option 3 ID :	**6306801565194**
Option 4 ID :	**6306801565193**
Status :	**Answered**
Chosen Option :	**1**

Q.24	**Four figure pairs have been given, out of which three are alike in a certain way and thus form a group. Which is the one that does not belong to that group?**
Ans	✗ 1. 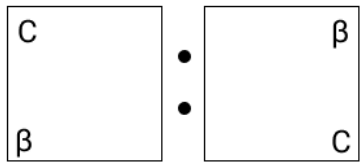
	✓ 2. 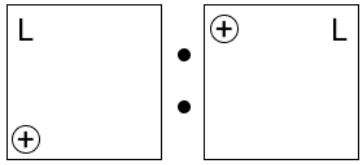
	✗ 3. 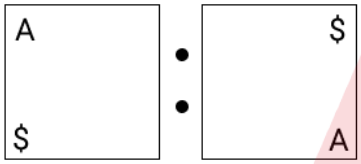
	✗ 4. 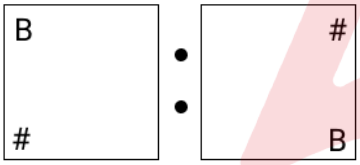

Question ID :	**630680570852**
Option 1 ID :	**6306802232471**
Option 2 ID :	**6306802232472**
Option 3 ID :	**6306802232469**
Option 4 ID :	**6306802232470**
Status :	**Answered**
Chosen Option :	**2**

Q.25	Two statements, I and II have been given. These statements may be independent causes or effects of independent causes or a common cause. One of the statements may be the effect of the other statement. Read both the statements and select the correct option. I) Refreshing and delicious salads are full of antioxidants, Vitamin A, Vitamin C, folate, calcium, fibre and phytonutrients, which are good for health. II) It is a perfect way to begin our day with salads in order to lead a healthy life.
Ans	✔ 1. I is the cause and II is its possible effect
	✘ 2. Both I and II are independent causes
	✘ 3. Both I and II are effects of independent causes
	✘ 4. II is the cause and I is its possible effect

Question ID :	630680387981
Option 1 ID :	6306801512538
Option 2 ID :	6306801512540
Option 3 ID :	6306801512541
Option 4 ID :	6306801512539
Status :	Answered
Chosen Option :	1

Q.26	Read the given statements and conclusions carefully. Assuming that the information given in the statements is true, even if it appears to be at variance with commonly known facts, decide which of the given conclusions logically follow(s) from the statements. Statements: Some rice is white. Some rice is brown. No white is wheat. Conclusions: I) Some wheat is brown. II) Some rice is not wheat. III) Some brown is not white.
Ans	✘ 1. Only I and III
	✘ 2. Only III
	✔ 3. Only II
	✘ 4. Only II and III

Question ID :	630680194948
Option 1 ID :	630680756282
Option 2 ID :	630680756284
Option 3 ID :	630680756283
Option 4 ID :	630680756281
Status :	Answered
Chosen Option :	3

Q.27	In a certain code language, ‘PAID’ is coded as ‘3274’ and ‘APED’ is coded as ‘6437’.What is the code for ‘E’ in that language?
Ans	✗ 1. 4
	✓ 2. 6
	✗ 3. 7
	✗ 4. 3

Question ID :	630680557126
Option 1 ID :	6306802177462
Option 2 ID :	6306802177459
Option 3 ID :	6306802177461
Option 4 ID :	6306802177460
Status :	Answered
Chosen Option :	2

Q.28	Select the set in which the numbers are related in the same way as are the numbers of the followingsets. (NOTE: Operations should be performed on the whole numbers, without breaking down the numbers into their constituent digits. E.g. 13 – Operations on 13 such as adding /subtracting /multiplying to 13 can be performed. Breaking down 13 into 1 and 3 and then performing mathematical operations on 1 and 3 is not allowed.) (7, 11, 33) (14, 18, 54)
Ans	✗ 1. (18, 21, 63)
	✗ 2. (5, 9, 36)
	✓ 3. (12, 16, 48)
	✗ 4. (16, 20, 40)

Question ID :	630680555991
Option 1 ID :	6306802173343
Option 2 ID :	6306802173341
Option 3 ID :	6306802173340
Option 4 ID :	6306802173342
Status :	Answered
Chosen Option :	3

Q.29	How many meaningful English words can be formed from R, O, W, D and C, using each letter mandatorily but only once in each word?
Ans	✗ 1. None
	✓ 2. One
	✗ 3. More than two
	✗ 4. Two

Question ID :	630680329065
Option 1 ID :	6306801280097
Option 2 ID :	6306801280098
Option 3 ID :	6306801280100
Option 4 ID :	6306801280099
Status :	Answered
Chosen Option :	2

Q.30	**Four figure pairs have been given, out of which three are alike in a certain way and thus form a group. Which is the one that does not belong to that group?**
Ans	✗ 1. 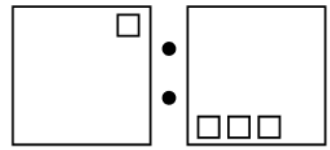
	✗ 2. 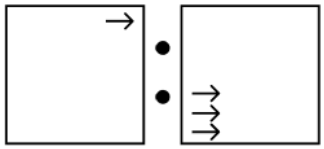
	✓ 3. 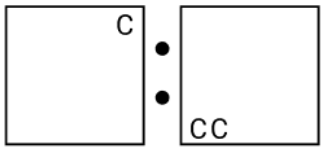
	✗ 4. 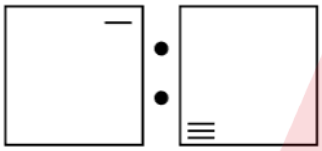

Question ID :	**630680570858**
Option 1 ID :	**6306802232496**
Option 2 ID :	**6306802232494**
Option 3 ID :	**6306802232495**
Option 4 ID :	**6306802232493**
Status :	**Answered**
Chosen Option :	**3**

Section : **Module I English Language and Comprehension**

Q.1	**Select the option that expresses the given sentence in passive voice. Doctors saved many lives during the pandemic.**
Ans	✗ 1. Many lives have been saved by doctors during the pandemic.
	✓ 2. Many lives were saved by doctors during the pandemic.
	✗ 3. Many lives were being saved by doctors during the pandemic.
	✗ 4. Many lives are saved by doctors during the pandemic.

Question ID :	**630680156606**
Option 1 ID :	**630680606080**
Option 2 ID :	**630680606083**
Option 3 ID :	**630680606081**
Option 4 ID :	**630680606082**
Status :	**Answered**
Chosen Option :	**2**

Q.2	**Select the option that expresses the given sentence in direct speech.** **He will say that he is okay.**
Ans	✗ 1. He would say, "I am okay."
	✗ 2. He will say, "I am always okay."
	✗ 3. He will say, "I was okay."
	✓ 4. He will say, "I am okay."

Question ID :	**630680156590**
Option 1 ID :	**630680606016**
Option 2 ID :	**630680606017**
Option 3 ID :	**630680606018**
Option 4 ID :	**630680606019**
Status :	**Answered**
Chosen Option :	**4**

Q.3	**Rearrange the jumbled words and choose the alternative that correctly matches the given sentence.** **The youth _____ now-a-days.** **life / of / today / a / leading / are / miserable**
Ans	✗ 1. today are leading of a miserable life
	✓ 2. of today are leading a miserable life
	✗ 3. are today leading of a miserable life
	✗ 4. today are leading a miserable life of

Question ID :	**630680123901**
Option 1 ID :	**630680480467**
Option 2 ID :	**630680480466**
Option 3 ID :	**630680480469**
Option 4 ID :	**630680480468**
Status :	**Answered**
Chosen Option :	**2**

Q.4	**Rearrange the jumbled words and choose the alternative that correctly matches the given sentence.** **The people of _____ to survive.** **are / this / island / commodities / deprived / essential / needed / remote / of**
Ans	✗ 1. remote island are deprived of essential commodities needed this
	✗ 2. this remote island are needed essential commodities deprived of
	✗ 3. this island are deprived of essential commodities needed remote
	✓ 4. this remote island are deprived of essential commodities needed

Question ID :	**630680123906**
Option 1 ID :	**630680480487**
Option 2 ID :	**630680480486**
Option 3 ID :	**630680480489**
Option 4 ID :	**630680480488**
Status :	**Answered**
Chosen Option :	**4**

Q.5	**Complete the sentence by choosing an appropriate word from the given options.** **He has not _____ returned the money.**
Ans	✗ 1. still
	✗ 2. only
	✓ 3. yet
	✗ 4. too

Question ID :	**630680120435**
Option 1 ID :	**630680466770**
Option 2 ID :	**630680466771**
Option 3 ID :	**630680466772**
Option 4 ID :	**630680466773**
Status :	**Answered**
Chosen Option :	**3**

Q.6	**Select the most appropriate meaning of the given idiom.** **Call it a day**
Ans	✓ 1. Stop working on something
	✗ 2. Begin with an assignment
	✗ 3. Name a particular day
	✗ 4. Involve many people for a simple job

Question ID :	**630680129526**
Option 1 ID :	**630680501723**
Option 2 ID :	**630680501724**
Option 3 ID :	**630680501722**
Option 4 ID :	**630680501725**
Status :	**Answered**
Chosen Option :	**1**

Q.7	**Select the most appropriate option to fill in the blank.** **His family lives _____ Mahu in Madhya Pradesh.**
Ans	✓ 1. at
	✗ 2. on
	✗ 3. of
	✗ 4. by

Question ID :	**630680120853**
Option 1 ID :	**630680468386**
Option 2 ID :	**630680468388**
Option 3 ID :	**630680468389**
Option 4 ID :	**630680468387**
Status :	**Answered**
Chosen Option :	**1**

Q.8	**Sentences of a paragraph are given below. While the first and the last sentences (S1 and S6) are in the correct order, the sentences in between are jumbled up. Arrange the sentences in the correct order to form a meaningful and coherent paragraph.** **S1. CV Raman's story begins in a village near Tiruchirapalli (known in his days as Trichinopoly) in southern India.** **P. When he was four years old, Raman's family moved to Vishakapatnam.** **Q. He was born on 8 November 1888, the second child of R Chandrashekara Iyer and Parvati Ammal.** **R. Chandrasekara Iyer was an athletic man and he took active interest in sports.** **S. His father took up a job there, as a lecturer in Mrs. AV Narsimha Rao College, where he taught physics, mathematics and physical geography.** **S6. His young son Raman was not physically very strong, but was very intelligent and he preferred to read books and work at his studies.**
Ans	✔ 1. QPSR
	✘ 2. SRPQ
	✘ 3. PQSR
	✘ 4. QPRS

Question ID :	**630680123831**
Option 1 ID :	**630680480195**
Option 2 ID :	**630680480196**
Option 3 ID :	**630680480194**
Option 4 ID :	**630680480197**
Status :	**Answered**
Chosen Option :	**1**

Q.9	**Select the most appropriate synonym of the given word.** **Abolish**
Ans	✘ 1. Assist
	✔ 2. Cancel
	✘ 3. Subside
	✘ 4. Worship

Question ID :	**630680123837**
Option 1 ID :	**630680480220**
Option 2 ID :	**630680480218**
Option 3 ID :	**630680480221**
Option 4 ID :	**630680480219**
Status :	**Answered**
Chosen Option :	**2**

Q.10	**Select the most appropriate option that can substitute the underlined segment in the given sentence.** **Harish is <u>clever than</u> wise.**
Ans	✗ 1. cleverest than
	✓ 2. more clever than
	✗ 3. clever as
	✗ 4. more cleverer than

Question ID :	**630680129269**
Option 1 ID :	**630680500705**
Option 2 ID :	**630680500703**
Option 3 ID :	**630680500702**
Option 4 ID :	**630680500704**
Status :	**Answered**
Chosen Option :	**2**

Q.11	**Select the option that expresses the given sentence in indirect speech.** **The patient says, "I am fine."**
Ans	✗ 1. The patient says that he will be fine.
	✓ 2. The patient says that he is fine.
	✗ 3. The patient says that he would be fine.
	✗ 4. The patient says that he was fine.

Question ID :	**630680156582**
Option 1 ID :	**630680605984**
Option 2 ID :	**630680605985**
Option 3 ID :	**630680605987**
Option 4 ID :	**630680605986**
Status :	**Answered**
Chosen Option :	**2**

Q.12	**Select the option that expresses the given sentence in passive voice.** **I remember my mother taking me to the stadium.**
Ans	✓ 1. I remember being taken to the stadium by my mother.
	✗ 2. I was taken to the stadium by mother that I remembered.
	✗ 3. My mother remembered me taken to the stadium.
	✗ 4. I was remembered being taken to the stadium by my mother.

Question ID :	**630680126832**
Option 1 ID :	**630680491848**
Option 2 ID :	**630680491847**
Option 3 ID :	**630680491846**
Option 4 ID :	**630680491849**
Status :	**Answered**
Chosen Option :	**1**

Q.13	Select the most appropriate synonym of the underlined word in the given sentence. Huxley was an <u>exponent</u> of Darwin's theory of evolution.
Ans	✗ 1. Cease
	✗ 2. Terminate
	✓ 3. Proponent
	✗ 4. Conclude

Question ID :	630680131743
Option 1 ID :	630680510183
Option 2 ID :	630680510184
Option 3 ID :	630680510182
Option 4 ID :	630680510185
Status :	Answered
Chosen Option :	3

Q.14	Select the most appropriate article(s) to fill in the blanks. I was in _____ state of unconsciousness for about half _____ hour.
Ans	✗ 1. the ; a
	✗ 2. a ; No article
	✓ 3. a ; an
	✗ 4. No article ; an

Question ID :	630680144484
Option 1 ID :	630680559003
Option 2 ID :	630680559005
Option 3 ID :	630680559004
Option 4 ID :	630680559002
Status :	Answered
Chosen Option :	3

Q.15	Select the most appropriate ANTONYM of the underlined word to fill in the blank. <u>Allies</u> have always come to his rescue in spite of his _____ attempts to defame him.
Ans	✗ 1. fellows'
	✗ 2. scholars'
	✗ 3. buddies'
	✓ 4. enemies'

Question ID :	630680156748
Option 1 ID :	630680606635
Option 2 ID :	630680606632
Option 3 ID :	630680606634
Option 4 ID :	630680606633
Status :	Answered
Chosen Option :	4

Q.16	**In the following sentence, a few of the spellings are incorrect. Find out the sentence with correctly spelt words from the given options.** **He is wimsical by natur. No one can seek an explanation from him for his absurd atitude towards others.**
Ans	✗ 1. He is wimsical by nature. No one can seek an explanation from him for his absurd attitude towards others.
	✗ 2. He is whimsical by natur. No one can seek an explanation from him for his absurd attitude towards others.
	✗ 3. He is whimsical by nature. No one can seek an explanation from him for his absurd atitude towards others.
	✓ 4. He is whimsical by nature. No one can seek an explanation from him for his absurd attitude towards others.

Question ID :	**630680121912**
Option 1 ID :	**630680472592**
Option 2 ID :	**630680472590**
Option 3 ID :	**630680472593**
Option 4 ID :	**630680472591**
Status :	**Answered**
Chosen Option :	**4**

Q.17	**Select the most appropriate adverb to fill in the blank.** **_____, I'm going to walk my dog.**
Ans	✗ 1. Annually
	✓ 2. Now
	✗ 3. Rarely
	✗ 4. Already

Question ID :	**630680119671**
Option 1 ID :	**630680463768**
Option 2 ID :	**630680463767**
Option 3 ID :	**630680463766**
Option 4 ID :	**630680463769**
Status :	**Answered**
Chosen Option :	**2**

Q.18	**Rearrange the jumbled words and choose the alternative that correctly matches the given sentence.** **I missed the _____for the next.** **usually / hour / which / for / board / had / wait / an / bus / I / and / to**
Ans	✗ 1. bus which I board and had to wait for an usually hour
	✓ 2. bus which I usually board and had to wait for an hour
	✗ 3. hour and had to wait for an bus which I usually board
	✗ 4. bus I usually board which had to wait for an hour and

Question ID :	**630680123907**
Option 1 ID :	**630680480490**
Option 2 ID :	**630680480491**
Option 3 ID :	**630680480492**
Option 4 ID :	**630680480493**
Status :	**Answered**
Chosen Option :	**2**

Q.19	Select the INCORRECTLY spelt word.
Ans	✗ 1. Intuition
	✗ 2. Instinctual
	✓ 3. Implusive
	✗ 4. Initiative

Question ID :	**630680130692**
Option 1 ID :	**630680506063**
Option 2 ID :	**630680506062**
Option 3 ID :	**630680506064**
Option 4 ID :	**630680506065**
Status :	**Answered**
Chosen Option :	**3**

Q.20	Select the most appropriate option to fill in the blank. The rising rate of inflation is making life very hard for _____ poor.
Ans	✓ 1. the
	✗ 2. some
	✗ 3. all
	✗ 4. its

Question ID :	**630680146285**
Option 1 ID :	**630680566030**
Option 2 ID :	**630680566031**
Option 3 ID :	**630680566032**
Option 4 ID :	**630680566033**
Status :	**Answered**
Chosen Option :	**1**

Q.21	Select the most appropriate synonym of the given word. Dingy
Ans	✗ 1. Pure
	✓ 2. Dreary
	✗ 3. Sterile
	✗ 4. Bright

Question ID :	**630680274317**
Option 1 ID :	**6306801065782**
Option 2 ID :	**6306801065779**
Option 3 ID :	**6306801065781**
Option 4 ID :	**6306801065780**
Status :	**Answered**
Chosen Option :	**2**

Q.22	Select the most appropriate option to fill in the blanks. It's funny how every time he fails to apply the _____ and _____ the glass.
Ans	✗ 1. breaks; breaks
	✓ 2. brakes; breaks
	✗ 3. breaks; brakes
	✗ 4. brakes; brakes

Question ID :	630680184934
Option 1 ID :	630680716688
Option 2 ID :	630680716686
Option 3 ID :	630680716685
Option 4 ID :	630680716687
Status :	Answered
Chosen Option :	2

Q.23	The following sentence has been split into four segments. Identify the segment that contains a grammatical error. The Supreme Court set away / the verdict of the High Court / and agreed to hear the plea / of the complainant.
Ans	✗ 1. the verdict of the High Court
	✓ 2. The Supreme Court set away
	✗ 3. of the complainant
	✗ 4. and agreed to hear the plea

Question ID :	630680146317
Option 1 ID :	630680566159
Option 2 ID :	630680566158
Option 3 ID :	630680566161
Option 4 ID :	630680566160
Status :	Not Answered
Chosen Option :	--

Q.24	Select the most appropriate phrasal verb that can substitute the underlined segment in the given sentence. The firefighters tried their best to extinguish the fire.
Ans	✗ 1. put in
	✓ 2. put out
	✗ 3. put off
	✗ 4. put on

Question ID :	630680126880
Option 1 ID :	630680492037
Option 2 ID :	630680492036
Option 3 ID :	630680492035
Option 4 ID :	630680492034
Status :	Answered
Chosen Option :	2

Q.25	**Select the option that expresses the given sentence in passive voice.** **The new sunshades have protected our windows during the rainy season.**
Ans	✗ 1. Our windows are being protected by the new sunshades during the rainy season.
	✓ 2. Our windows have been protected by the new sunshades during the rainy season.
	✗ 3. Our windows are being protected by the new windows during the rainy season.
	✗ 4. Our sunshades have been protected by the new windows during the rainy season.

Question ID :	**630680133595**
Option 1 ID :	**630680517339**
Option 2 ID :	**630680517338**
Option 3 ID :	**630680517341**
Option 4 ID :	**630680517340**
Status :	**Answered**
Chosen Option :	**2**

Q.26	**Replace the underlined word in the given sentence with its correctly spelt version.** **I have been morning the death of my pet dog.**
Ans	✗ 1. merning
	✗ 2. moruning
	✓ 3. mourning
	✗ 4. murning

Question ID :	**630680123960**
Option 1 ID :	**630680480700**
Option 2 ID :	**630680480698**
Option 3 ID :	**630680480701**
Option 4 ID :	**630680480699**
Status :	**Answered**
Chosen Option :	**3**

Q.27	**Select the most appropriate option that can substitute the underlined segment in the given sentence.** **Research in Social Sciences is plagued nowadays on gloomy definitions and measurements.**
Ans	✗ 1. nowadays amid gloomy definitions
	✓ 2. nowadays by gloomy definitions
	✗ 3. nowadays during gloomy definitions
	✗ 4. nowadays onto gloomy definitions

Question ID :	**630680147436**
Option 1 ID :	**630680570526**
Option 2 ID :	**630680570527**
Option 3 ID :	**630680570528**
Option 4 ID :	**630680570529**
Status :	**Answered**
Chosen Option :	**2**

Q.28	**Select the option that expresses the given sentence in indirect speech.** **He always says to me, "I am perturbed."**
Ans	✗ 1. He always tells me that he is mostly perturbed.
	✓ 2. He always tells me that he is perturbed.
	✗ 3. He always tells me that he is perturbed by change.
	✗ 4. He always tells me that he is going to be perturbed.

Question ID :	**630680156583**
Option 1 ID :	**630680605989**
Option 2 ID :	**630680605990**
Option 3 ID :	**630680605991**
Option 4 ID :	**630680605988**
Status :	**Answered**
Chosen Option :	**2**

	Comprehension:
	In the following passage, some words have been deleted. Read the passage carefully and select the most appropriate option to fill in each blank. During active sleep, the body is still, (1)_____ the brain is active. The eyes dart back and forth behind closed lids, blood pressure (2)_____ and the breathing pattern speeds up. An EEG of someone during rapid eye movement sleep looks almost the same as the EEG of a person in the waking state, although one is still asleep and the body is still immobile. Rapid eye movement sleep plays a vital role in harmonising the experiences we have in the world outside. An EEG of someone during rapid eye movement sleep looks almost the same as the EEG of a person in the (3)_____ state, although one is still asleep and the body is still (4)_____. Rapid eye movement during sleep plays a vital role in harmonising the experiences we have in the world outside.
	SubQuestion No : 29
Q.29	**Select the most appropriate option to fill in blank number 1.**
Ans	✗ 1. neither
	✗ 2. therefore
	✗ 3. so
	✓ 4. but

Question ID :	**630680396468**
Option 1 ID :	**6306801545972**
Option 2 ID :	**6306801545971**
Option 3 ID :	**6306801545973**
Option 4 ID :	**6306801545974**
Status :	**Answered**
Chosen Option :	**4**

	Comprehension:
	In the following passage, some words have been deleted. Read the passage carefully and select the most appropriate option to fill in each blank. During active sleep, the body is still, (1)_____ the brain is active. The eyes dart back and forth behind closed lids, blood pressure (2)_____ and the breathing pattern speeds up. An EEG of someone during rapid eye movement sleep looks almost the same as the EEG of a person in the waking state, although one is still asleep and the body is still immobile. Rapid eye movement sleep plays a vital role in harmonising the experiences we have in the world outside. An EEG of someone during rapid eye movement sleep looks almost the same as the EEG of a person in the (3)_____ state, although one is still asleep and the body is still (4)_____. Rapid eye movement during sleep plays a vital role in harmonising the experiences we have in the world outside.
	SubQuestion No : 30
Q.30	**Select the most appropriate option to fill in blank number 2.**
Ans	✗ 1. relaxes
	✗ 2. beeps
	✗ 3. stables
	✓ 4. increases

Question ID :	**630680396469**
Option 1 ID :	**6306801545976**
Option 2 ID :	**6306801545977**
Option 3 ID :	**6306801545975**
Option 4 ID :	**6306801545978**
Status :	**Answered**
Chosen Option :	**4**

	Comprehension:
	In the following passage, some words have been deleted. Read the passage carefully and select the most appropriate option to fill in each blank. During active sleep, the body is still, (1)_____ the brain is active. The eyes dart back and forth behind closed lids, blood pressure (2)_____ and the breathing pattern speeds up. An EEG of someone during rapid eye movement sleep looks almost the same as the EEG of a person in the waking state, although one is still asleep and the body is still immobile. Rapid eye movement sleep plays a vital role in harmonising the experiences we have in the world outside. An EEG of someone during rapid eye movement sleep looks almost the same as the EEG of a person in the (3)_____ state, although one is still asleep and the body is still (4)_____. Rapid eye movement during sleep plays a vital role in harmonising the experiences we have in the world outside.
	SubQuestion No : 31
Q.31	**Select the most appropriate option to fill in blank number 3.**
Ans	✗ 1. sleeping
	✗ 2. standing
	✓ 3. waking
	✗ 4. eating

Question ID :	**630680396470**
Option 1 ID :	**6306801545979**
Option 2 ID :	**6306801545981**
Option 3 ID :	**6306801545980**
Option 4 ID :	**6306801545982**
Status :	**Answered**
Chosen Option :	**3**

	Comprehension:
	In the following passage, some words have been deleted. Read the passage carefully and select the most appropriate option to fill in each blank. During active sleep, the body is still, (1)_____ the brain is active. The eyes dart back and forth behind closed lids, blood pressure (2)_____ and the breathing pattern speeds up. An EEG of someone during rapid eye movement sleep looks almost the same as the EEG of a person in the waking state, although one is still asleep and the body is still immobile. Rapid eye movement sleep plays a vital role in harmonising the experiences we have in the world outside. An EEG of someone during rapid eye movement sleep looks almost the same as the EEG of a person in the (3)_____ state, although one is still asleep and the body is still (4)_____. Rapid eye movement during sleep plays a vital role in harmonising the experiences we have in the world outside.
	SubQuestion No : 32
Q.32	**Select the most appropriate option to fill in blank number 4.**
Ans	✗ 1. conscious
	✓ 2. immobile
	✗ 3. performing
	✗ 4. active

Question ID :	**630680396471**
Option 1 ID :	**6306801545985**
Option 2 ID :	**6306801545984**
Option 3 ID :	**6306801545986**
Option 4 ID :	**6306801545983**
Status :	**Answered**
Chosen Option :	**2**

	Comprehension:
	Read the given passage and answer the question that follows. Lena was an avid explorer. She had a deep fascination for the mysteries hidden within the dense forests. One day, while wandering through a secluded forest, she stumbled upon an ancient-looking map half-buried in the undergrowth. The map depicted a trail that led to a legendary waterfall rumoured to possess magical properties. Driven by her curiosity, Lena decided to follow the trail. As she walked deeper into the forest, the atmosphere grew more enchanting. Sunlight filtered through the thick canopy, casting dappled patterns on the ground. The sound of rustling leaves and distant bird calls created a symphony of nature around her. Guided by the map's markings, Lena navigated through challenging terrains and crossed a narrow rope bridge suspended over a crystal-clear stream. Finally, after hours of journeying, Lena arrived at the foot of the legendary waterfall. Its cascading waters sparkled like diamonds in the sunlight, and a gentle mist enveloped the surroundings. Lena felt a sense of wonder and tranquillity as she dipped her hand in the cool waters, as if the legends were coming alive. She sat by the waterfall, captivated by its beauty, pondering the ancient stories that had led her here.
	SubQuestion No : 33
Q.33	**What intrigued Lena's curiosity in the forest?**
Ans	✗ 1. She heard whispers in the wind.
	✗ 2. She found a hidden cave.
	✓ 3. She stumbled upon an ancient map.
	✗ 4. She discovered an old book.

Question ID :	**630680395346**
Option 1 ID :	**6306801541587**
Option 2 ID :	**6306801541584**
Option 3 ID :	**6306801541586**
Option 4 ID :	**6306801541585**
Status :	**Answered**
Chosen Option :	**3**

	Comprehension:
	Read the given passage and answer the question that follows. Lena was an avid explorer. She had a deep fascination for the mysteries hidden within the dense forests. One day, while wandering through a secluded forest, she stumbled upon an ancient-looking map half-buried in the undergrowth. The map depicted a trail that led to a legendary waterfall rumoured to possess magical properties. Driven by her curiosity, Lena decided to follow the trail. As she walked deeper into the forest, the atmosphere grew more enchanting. Sunlight filtered through the thick canopy, casting dappled patterns on the ground. The sound of rustling leaves and distant bird calls created a symphony of nature around her. Guided by the map's markings, Lena navigated through challenging terrains and crossed a narrow rope bridge suspended over a crystal-clear stream. Finally, after hours of journeying, Lena arrived at the foot of the legendary waterfall. Its cascading waters sparkled like diamonds in the sunlight, and a gentle mist enveloped the surroundings. Lena felt a sense of wonder and tranquillity as she dipped her hand in the cool waters, as if the legends were coming alive. She sat by the waterfall, captivated by its beauty, pondering the ancient stories that had led her here.
	SubQuestion No : 34
Q.34	**Select the most appropriate ANTONYM of the underlined word in the given sentence.** **What <u>surrounded</u> Lena as she journeyed through the forest?**
Ans	✔ 1. Freed
	✗ 2. Created
	✗ 3. Girded
	✗ 4. Bolt

Question ID :	**630680395349**
Option 1 ID :	**6306801541598**
Option 2 ID :	**6306801541599**
Option 3 ID :	**6306801541597**
Option 4 ID :	**6306801541596**
Status :	**Answered**
Chosen Option :	**1**

	Comprehension:
	Read the given passage and answer the question that follows. Lena was an avid explorer. She had a deep fascination for the mysteries hidden within the dense forests. One day, while wandering through a secluded forest, she stumbled upon an ancient-looking map half-buried in the undergrowth. The map depicted a trail that led to a legendary waterfall rumoured to possess magical properties. Driven by her curiosity, Lena decided to follow the trail. As she walked deeper into the forest, the atmosphere grew more enchanting. Sunlight filtered through the thick canopy, casting dappled patterns on the ground. The sound of rustling leaves and distant bird calls created a symphony of nature around her. Guided by the map's markings, Lena navigated through challenging terrains and crossed a narrow rope bridge suspended over a crystal-clear stream. Finally, after hours of journeying, Lena arrived at the foot of the legendary waterfall. Its cascading waters sparkled like diamonds in the sunlight, and a gentle mist enveloped the surroundings. Lena felt a sense of wonder and tranquillity as she dipped her hand in the cool waters, as if the legends were coming alive. She sat by the waterfall, captivated by its beauty, pondering the ancient stories that had led her here.
	SubQuestion No : 35
Q.35	**Select the correct spelling of the underlined word in the given sentence.** **What was Lena's reason for following the <u>trial</u> on the map?**
Ans	✗ 1. Triall
	✓ 2. Trail
	✗ 3. Treil
	✗ 4. Trale

Question ID :	**630680395348**
Option 1 ID :	**6306801541594**
Option 2 ID :	**6306801541592**
Option 3 ID :	**6306801541595**
Option 4 ID :	**6306801541593**
Status :	**Answered**
Chosen Option :	**2**

	Comprehension:
	Read the given passage and answer the question that follows. Lena was an avid explorer. She had a deep fascination for the mysteries hidden within the dense forests. One day, while wandering through a secluded forest, she stumbled upon an ancient-looking map half-buried in the undergrowth. The map depicted a trail that led to a legendary waterfall rumoured to possess magical properties. Driven by her curiosity, Lena decided to follow the trail. As she walked deeper into the forest, the atmosphere grew more enchanting. Sunlight filtered through the thick canopy, casting dappled patterns on the ground. The sound of rustling leaves and distant bird calls created a symphony of nature around her. Guided by the map's markings, Lena navigated through challenging terrains and crossed a narrow rope bridge suspended over a crystal-clear stream. Finally, after hours of journeying, Lena arrived at the foot of the legendary waterfall. Its cascading waters sparkled like diamonds in the sunlight, and a gentle mist enveloped the surroundings. Lena felt a sense of wonder and tranquillity as she dipped her hand in the cool waters, as if the legends were coming alive. She sat by the waterfall, captivated by its beauty, pondering the ancient stories that had led her here.
	SubQuestion No : 36
Q.36	**Where did Lena find the map?**
Ans	✗ 1. Buried in the sand
	✗ 2. In a bookstore in town
	✗ 3. Underneath a bridge
	✓ 4. Half-buried in the undergrowth

Question ID :	**630680395347**
Option 1 ID :	**6306801541590**
Option 2 ID :	**6306801541588**
Option 3 ID :	**6306801541589**
Option 4 ID :	**6306801541591**
Status :	**Answered**
Chosen Option :	**4**

	Comprehension:
	Read the given passage and answer the question that follows. As a result of increasing population and expansion of residential areas, forest lands are being encroached. This is not all; even the wildlife is under extreme threat. As our fauna is facing a dearth of adequate shelter in forests, they are heading towards towns and hence get killed by hunters. Consequently, many animal species have either become extinct or are on the verge of extinction. The Black Buck is almost endangered and found only in two countries, Nepal and India. In India, this antelope is found in many national parks like Guindy National Park, Point Calimere and Vellandu sanctuaries of Tamil Nadu, Rollapadu of Andra Pradesh, few parts of Rajasthan and Haryana. As far as their habitat is concerned, they live in open grasslands, dry areas or thinly populated areas and near water resources. They live in the desert areas of Rajasthan and coastal areas because they cannot sustain cold climate. They are the fastest running animals on this planet. Further, this animal is active during the day, but slows down in its activities after mid-day. They are social beings. Hence, they move with their herds, which can vary from 3 to 23 mates. They cohabit twice in a year and give birth twice in a year. Prior to independence, this antelope was extensively hunted which affected their population so much that this species has reached the stage of extinction in many parts of the country. Poachers kill them mainly for material gain. Its skin has an enormous value in the market. In order to protect this species, the IUCN has declared this species nearly threatened. Hence, under Schedule I of the Wildlife Protection Act of 1972, numerous stern measures have been taken. To specify a few, Kaimur Wildlife Sanctuary (Bihar), Gir Forest National Park, Velavadar Wildlife Sanctuary (Gujarat), National Chambal Sanctuary, etc. Despite these acts, hunting is adversely affecting our wildlife. There are some solutions to this problem but the best one is to boycott the products made from endangered species at an international level. This seems to be effective but will it prevent animal hunting? That's a question.
	SubQuestion No : 37
Q.37	**What is the theme of this passage?**
Ans	✔ 1. Endangered species
	✘ 2. Over-population
	✘ 3. Land encroachment
	✘ 4. Forests and their uses

Question ID :	**630680399392**
Option 1 ID :	**6306801557492**
Option 2 ID :	**6306801557491**
Option 3 ID :	**6306801557494**
Option 4 ID :	**6306801557493**
Status :	**Answered**
Chosen Option :	**1**

	Comprehension:
	Read the given passage and answer the question that follows. As a result of increasing population and expansion of residential areas, forest lands are being encroached. This is not all; even the wildlife is under extreme threat. As our fauna is facing a dearth of adequate shelter in forests, they are heading towards towns and hence get killed by hunters. Consequently, many animal species have either become extinct or are on the verge of extinction. The Black Buck is almost endangered and found only in two countries, Nepal and India. In India, this antelope is found in many national parks like Guindy National Park, Point Calimere and Vellandu sanctuaries of Tamil Nadu, Rollapadu of Andra Pradesh, few parts of Rajasthan and Haryana. As far as their habitat is concerned, they live in open grasslands, dry areas or thinly populated areas and near water resources. They live in the desert areas of Rajasthan and coastal areas because they cannot sustain cold climate. They are the fastest running animals on this planet. Further, this animal is active during the day, but slows down in its activities after mid-day. They are social beings. Hence, they move with their herds, which can vary from 3 to 23 mates. They cohabit twice in a year and give birth twice in a year. Prior to independence, this antelope was extensively hunted which affected their population so much that this species has reached the stage of extinction in many parts of the country. Poachers kill them mainly for material gain. Its skin has an enormous value in the market. In order to protect this species, the IUCN has declared this species nearly threatened. Hence, under Schedule I of the Wildlife Protection Act of 1972, numerous stern measures have been taken. To specify a few, Kaimur Wildlife Sanctuary (Bihar), Gir Forest National Park, Velavadar Wildlife Sanctuary (Gujarat), National Chambal Sanctuary, etc. Despite these acts, hunting is adversely affecting our wildlife. There are some solutions to this problem but the best one is to boycott the products made from endangered species at an international level. This seems to be effective but will it prevent animal hunting? That's a question.

	SubQuestion No : 38
Q.38	**Choose the word which closely means 'adversely'.**
Ans	✗ 1. Digressing
	✓ 2. Detrimentally
	✗ 3. Scarcely
	✗ 4. Distressing

Question ID :	**630680399394**
Option 1 ID :	**6306801557501**
Option 2 ID :	**6306801557499**
Option 3 ID :	**6306801557500**
Option 4 ID :	**6306801557502**
Status :	**Answered**
Chosen Option :	**2**

	Comprehension:
	Read the given passage and answer the question that follows. As a result of increasing population and expansion of residential areas, forest lands are being encroached. This is not all; even the wildlife is under extreme threat. As our fauna is facing a dearth of adequate shelter in forests, they are heading towards towns and hence get killed by hunters. Consequently, many animal species have either become extinct or are on the verge of extinction. The Black Buck is almost endangered and found only in two countries, Nepal and India. In India, this antelope is found in many national parks like Guindy National Park, Point Calimere and Vellandu sanctuaries of Tamil Nadu, Rollapadu of Andra Pradesh, few parts of Rajasthan and Haryana. As far as their habitat is concerned, they live in open grasslands, dry areas or thinly populated areas and near water resources. They live in the desert areas of Rajasthan and coastal areas because they cannot sustain cold climate. They are the fastest running animals on this planet. Further, this animal is active during the day, but slows down in its activities after mid-day. They are social beings. Hence, they move with their herds, which can vary from 3 to 23 mates. They cohabit twice in a year and give birth twice in a year. Prior to independence, this antelope was extensively hunted which affected their population so much that this species has reached the stage of extinction in many parts of the country. Poachers kill them mainly for material gain. Its skin has an enormous value in the market. In order to protect this species, the IUCN has declared this species nearly threatened. Hence, under Schedule I of the Wildlife Protection Act of 1972, numerous stern measures have been taken. To specify a few, Kaimur Wildlife Sanctuary (Bihar), Gir Forest National Park, Velavadar Wildlife Sanctuary (Gujarat), National Chambal Sanctuary, etc. Despite these acts, hunting is adversely affecting our wildlife. There are some solutions to this problem but the best one is to boycott the products made from endangered species at an international level. This seems to be effective but will it prevent animal hunting? That's a question.
	SubQuestion No : 39
Q.39	**What is the author's tone in this passage?**
Ans	✔ 1. Concerned
	✘ 2. Revengeful
	✘ 3. Impressed
	✘ 4. Agitated

Question ID :	**630680399395**
Option 1 ID :	**6306801557503**
Option 2 ID :	**6306801557506**
Option 3 ID :	**6306801557505**
Option 4 ID :	**6306801557504**
Status :	**Answered**
Chosen Option :	**1**

	Comprehension:
	Read the given passage and answer the question that follows. As a result of increasing population and expansion of residential areas, forest lands are being encroached. This is not all; even the wildlife is under extreme threat. As our fauna is facing a dearth of adequate shelter in forests, they are heading towards towns and hence get killed by hunters. Consequently, many animal species have either become extinct or are on the verge of extinction. The Black Buck is almost endangered and found only in two countries, Nepal and India. In India, this antelope is found in many national parks like Guindy National Park, Point Calimere and Vellandu sanctuaries of Tamil Nadu, Rollapadu of Andra Pradesh, few parts of Rajasthan and Haryana. As far as their habitat is concerned, they live in open grasslands, dry areas or thinly populated areas and near water resources. They live in the desert areas of Rajasthan and coastal areas because they cannot sustain cold climate. They are the fastest running animals on this planet. Further, this animal is active during the day, but slows down in its activities after mid-day. They are social beings. Hence, they move with their herds, which can vary from 3 to 23 mates. They cohabit twice in a year and give birth twice in a year. Prior to independence, this antelope was extensively hunted which affected their population so much that this species has reached the stage of extinction in many parts of the country. Poachers kill them mainly for material gain. Its skin has an enormous value in the market. In order to protect this species, the IUCN has declared this species nearly threatened. Hence, under Schedule I of the Wildlife Protection Act of 1972, numerous stern measures have been taken. To specify a few, Kaimur Wildlife Sanctuary (Bihar), Gir Forest National Park, Velavadar Wildlife Sanctuary (Gujarat), National Chambal Sanctuary, etc. Despite these acts, hunting is adversely affecting our wildlife. There are some solutions to this problem but the best one is to boycott the products made from endangered species at an international level. This seems to be effective but will it prevent animal hunting? That's a question.
	SubQuestion No : 40
Q.40	**The Black Buck is killed because of hunters' _____.**
Ans	✔ 1. material gain
	✘ 2. need
	✘ 3. fun
	✘ 4. personal gratification

Question ID :	**630680399393**
Option 1 ID :	**6306801557497**
Option 2 ID :	**6306801557495**
Option 3 ID :	**6306801557498**
Option 4 ID :	**6306801557496**
Status :	**Answered**
Chosen Option :	**1**

Section : **Module II General Awareness**

Q.1	**A part of the cell other than the nucleus which has DNA and ribosomes and can thus make its own proteins is known as:**
Ans	✔ 1. mitochondria
	✘ 2. endoplasmic reticulum
	✘ 3. ribosomes
	✘ 4. Golgi apparatus

Question ID :	**630680560992**
Option 1 ID :	**6306802192973**
Option 2 ID :	**6306802192974**
Option 3 ID :	**6306802192976**
Option 4 ID :	**6306802192975**
Status :	**Marked For Review**
Chosen Option :	**2**

Q.2	Who propounded the famous equation $E = mc^2$ in 1905?
Ans	✔ 1. Albert Einstein
	✘ 2. Isaac Newton
	✘ 3. Werner Heisenberg
	✘ 4. Ernest Rutherford

Question ID :	**63068094239**
Option 1 ID :	**630680365651**
Option 2 ID :	**630680365652**
Option 3 ID :	**630680365654**
Option 4 ID :	**630680365653**
Status :	**Answered**
Chosen Option :	**1**

Q.3	Which of the following statements is correct regarding the jurisdiction of the Supreme Court of India?
Ans	✘ 1. The original jurisdiction of the Supreme Court can be invoked by a certificate granted by the High Court.
	✘ 2. The Supreme Court has a very wide advisory jurisdiction over all courts and tribunals in India.
	✔ 3. The original jurisdiction extends to any dispute between the Government of India and one or more State.
	✘ 4. Article 30 of the Constitution of India gives an extensive original jurisdiction to the Supreme Court.

Question ID :	**630680615326**
Option 1 ID :	**6306802407980**
Option 2 ID :	**6306802407981**
Option 3 ID :	**6306802407978**
Option 4 ID :	**6306802407979**
Status :	**Marked For Review**
Chosen Option :	**3**

Q.4	The torrid zone lies between _____.
Ans	✘ 1. Antarctic Circle and Tropic of Capricorn
	✘ 2. North Pole and Arctic Circle
	✔ 3. Tropic of Cancer and Tropic of Capricorn
	✘ 4. Arctic Circle and Tropic of Cancer

Question ID :	**630680565159**
Option 1 ID :	**6306802209611**
Option 2 ID :	**6306802209612**
Option 3 ID :	**6306802209609**
Option 4 ID :	**6306802209610**
Status :	**Answered**
Chosen Option :	**1**

Q.5	Match the following.
Ans	✗ 1. 1-a, 2-b, 3-c
	✓ 2. 1-b, 2-c, 3-a
	✗ 3. 1-a, 2-c, 3-b
	✗ 4. 1-c, 2-b, 3-a

Question ID :	630680310802
Option 1 ID :	6306801209338
Option 2 ID :	6306801209340
Option 3 ID :	6306801209339
Option 4 ID :	6306801209337
Status :	Answered
Chosen Option :	2

Q.6	How many phases are involved in the census operations in India?
Ans	✗ 1. Four
	✗ 2. One
	✗ 3. Three
	✓ 4. Two

Question ID :	630680663955
Option 1 ID :	6306802599462
Option 2 ID :	6306802599459
Option 3 ID :	6306802599461
Option 4 ID :	6306802599460
Status :	Answered
Chosen Option :	4

Q.7	The number of atoms in exactly 12 g of carbon-12 is known as:
Ans	✗ 1. Faraday's constant
	✗ 2. Rydberg constant
	✗ 3. Planck's constant
	✓ 4. Avogadro's constant

Question ID :	63068098948
Option 1 ID :	630680384498
Option 2 ID :	630680384499
Option 3 ID :	630680384496
Option 4 ID :	630680384497
Status :	Answered
Chosen Option :	4

Q.8	Who among the following participated in the All-World Religious Conference (Parliament of Religions) held in 1893 in Chicago?
Ans	✗ 1. Swami Shahjananda
	✗ 2. Swami Dayanand
	✗ 3. Raja Ram Mohan Roy
	✓ 4. Swami Vivekananda

Question ID :	**630680282916**
Option 1 ID :	**6306801099796**
Option 2 ID :	**6306801099797**
Option 3 ID :	**6306801099795**
Option 4 ID :	**6306801099798**
Status :	**Answered**
Chosen Option :	**4**

Q.9	The pH value of the curd is:
Ans	✗ 1. higher than 7
	✗ 2. nearly 7
	✓ 3. lower than the pH value of milk
	✗ 4. higher than the pH value of milk

Question ID :	**630680309363**
Option 1 ID :	**6306801203612**
Option 2 ID :	**6306801203611**
Option 3 ID :	**6306801203610**
Option 4 ID :	**6306801203609**
Status :	**Marked For Review**
Chosen Option :	**4**

Q.10	Choose the correct order of the following plateaus and mountain ranges from south to north of India.
Ans	✗ 1. Malwa Plateau, Satpura Range, Vindhya Range, and Deccan Plateau
	✗ 2. Malwa Plateau, Vindhya Range, Satpura Range, and Deccan Plateau
	✓ 3. Deccan Plateau, Satpura Range, Vindhya Range, and Malwa Plateau
	✗ 4. Deccan Plateau, Vindhya Range, Satpura Range, and Malwa Plateau

Question ID :	**630680309369**
Option 1 ID :	**6306801203634**
Option 2 ID :	**6306801203636**
Option 3 ID :	**6306801203635**
Option 4 ID :	**6306801203633**
Status :	**Marked For Review**
Chosen Option :	**3**

Q.11	**Which of the following statements regarding orographic rainfall is correct?**
Ans	✗ 1. This precipitation is heavy but of short duration, highly localised and is associated with minimum amount of cloudiness.
	✓ 2. This type of precipitation occurs when warm, humid air strikes on a mountain range.
	✗ 3. This type of precipitation is characterised by seasonal reversal of winds that carry oceanic moisture.
	✗ 4. It occurs mainly during summer and is common over equatorial doldrums in the Congo basin.

Question ID :	**63068094178**
Option 1 ID :	**630680365408**
Option 2 ID :	**630680365407**
Option 3 ID :	**630680365410**
Option 4 ID :	**630680365409**
Status :	**Answered**
Chosen Option :	**2**

Q.12	**Which of the following is NOT the feature of Fundamental Duties provided under the Constitution of India?**
Ans	✗ 1. Duties are inspired from erstwhile USSR
	✗ 2. Duties are non- justiciable in nature
	✓ 3. Duties are enforceable by the law
	✗ 4. Duties are intended to secure the country

Question ID :	**630680287349**
Option 1 ID :	**6306801117305**
Option 2 ID :	**6306801117306**
Option 3 ID :	**6306801117303**
Option 4 ID :	**6306801117304**
Status :	**Answered**
Chosen Option :	**3**

Q.13	**Which of the following statements regarding the functions of money is/are true?** **1. Money as a unit of account means it is a standard numerical unit of measurement of the market value of goods, services and other transactions.** **2. Money as a standard of deferred payment is not a significant function because modern economies rarely use money for future payments.**
Ans	✗ 1. Neither 1 nor 2
	✓ 2. Only 1
	✗ 3. Both 1 and 2
	✗ 4. Only 2

Question ID :	**630680564435**
Option 1 ID :	**6306802206642**
Option 2 ID :	**6306802206639**
Option 3 ID :	**6306802206641**
Option 4 ID :	**6306802206640**
Status :	**Not Answered**
Chosen Option :	**--**

Q.14	**When was International Anti-Corruption Day Celebrated in 2021 (an annual event) to raise awareness and find newer ways to combat corruption?**
Ans	✗ 1. 4 February
	✗ 2. 16 January
	✗ 3. 19 August
	✓ 4. 9 December

Question ID :	**630680112125**
Option 1 ID :	**630680434228**
Option 2 ID :	**630680434227**
Option 3 ID :	**630680434229**
Option 4 ID :	**630680434226**
Status :	**Not Answered**
Chosen Option :	**--**

Q.15	**Which of the following duties is specified as the 10th Fundamental Duty in the Indian Constitution?**
Ans	✗ 1. To develop the scientific temper, humanism and the spirit of inquiry and reform
	✓ 2. To strive towards excellence in all spheres of individual and collective activity
	✗ 3. To cherish and follow the noble ideals which inspired our national struggle for freedom
	✗ 4. To provide opportunities for education to his child or as the case may be, ward between the age of six and fourteen years

Question ID :	**630680275852**
Option 1 ID :	**6306801071919**
Option 2 ID :	**6306801071922**
Option 3 ID :	**6306801071920**
Option 4 ID :	**6306801071921**
Status :	**Not Answered**
Chosen Option :	**--**

Q.16	Match the following microfinance concepts with their descriptions.	
	List I (Concepts)	List II (Descriptions)
	(a) Microcredit	(i) Small, often peer-monitored savings products designed for low-income individuals
	(b) Microsavings	(ii) Financial protection against specific perils for low-income populations
	(c) Microinsurance	(iii) The use of group responsibility as a guarantee for loan repayment
	(d) Social Collateral	(iv) Small loans provided to entrepreneurs too poor to qualify for traditional bank loans

Ans	
✗	1. a-(ii), b-(iii), c-(i), d-(iv)
✗	2. a-(i), b-(ii), c-(iii), d-(iv)
✗	3. a-(iii), b-(iv), c-(i), d-(ii)
✓	4. a-(iv), b-(i), c-(ii), d-(iii)

Question ID :	**630680564440**
Option 1 ID :	**6306802206660**
Option 2 ID :	**6306802206662**
Option 3 ID :	**6306802206661**
Option 4 ID :	**6306802206659**
Status :	**Answered**
Chosen Option :	**4**

Q.17	Central Vigilance Commission observed Vigilance Awareness Week 2022 with which of the following themes?
Ans	✗ 1. Vigilant India, Prosperous India
	✓ 2. Corruption free India for a developed Nation
	✗ 3. Independent India @ 75: Self Reliance with Integrity
	✗ 4. Integrity A way of life

Question ID :	**630680269940**
Option 1 ID :	**6306801049013**
Option 2 ID :	**6306801049011**
Option 3 ID :	**6306801049012**
Option 4 ID :	**6306801049014**
Status :	**Not Answered**
Chosen Option :	**--**

Q.18	In 2021, Union Minister Jitendra Singh inaugurated the X-band Doppler Weather Radar to provide improved forecasts. Where was it inaugurated?
Ans	✓ 1. Jammu
	✗ 2. Ladakh
	✗ 3. Chandigarh
	✗ 4. Puducherry

Question ID :	**630680115313**
Option 1 ID :	**630680446603**
Option 2 ID :	**630680446604**
Option 3 ID :	**630680446602**
Option 4 ID :	**630680446605**
Status :	**Not Answered**
Chosen Option :	**--**

Q.19	Nataraja represents the dancing figure of which Hindu deity?
Ans	✔ 1. Shiva
	✘ 2. Kartikeya
	✘ 3. Vishnu
	✘ 4. Ganesh

Question ID :	**630680309304**
Option 1 ID :	**6306801203376**
Option 2 ID :	**6306801203374**
Option 3 ID :	**6306801203375**
Option 4 ID :	**6306801203373**
Status :	**Answered**
Chosen Option :	**1**

Q.20	What is the cottony growth over a stale and moist bread known as?
Ans	✔ 1. Fungi
	✘ 2. Lichens
	✘ 3. Algae
	✘ 4. Bacteria

Question ID :	**630680561034**
Option 1 ID :	**6306802193083**
Option 2 ID :	**6306802193084**
Option 3 ID :	**6306802193082**
Option 4 ID :	**6306802193081**
Status :	**Marked For Review**
Chosen Option :	**1**

Section : **Module I Computer Knowledge Module**

Q.1	What does the Ctrl + V shortcut key do?
Ans	✘ 1. Finds text in a document
	✘ 2. Saves the document
	✘ 3. Cuts the selected content
	✔ 4. Pastes the copied content

Question ID :	**6306801147368**
Option 1 ID :	**6306804509598**
Option 2 ID :	**6306804509597**
Option 3 ID :	**6306804509596**
Option 4 ID :	**6306804509599**
Status :	**Answered**
Chosen Option :	**4**

Q.2	Which option in the print dialog allows you to save a web page as a digital file instead of printing it?
Ans	✔ 1. Save as PDF
	✘ 2. Print preview
	✘ 3. Print to file
	✘ 4. Select printer

Question ID :	**6306801149600**
Option 1 ID :	**6306804518438**
Option 2 ID :	**6306804518439**
Option 3 ID :	**6306804518437**
Option 4 ID :	**6306804518440**
Status :	**Answered**
Chosen Option :	**1**

Q.3	In symmetric encryption, how many keys are used to encrypt and decrypt data?
Ans	✘ 1. Two Keys
	✔ 2. One Key
	✘ 3. No Key
	✘ 4. Three Keys

Question ID :	**6306801148919**
Option 1 ID :	**6306804515741**
Option 2 ID :	**6306804515740**
Option 3 ID :	**6306804515743**
Option 4 ID :	**6306804515742**
Status :	**Not Answered**
Chosen Option :	**--**

Q.4	Which of the following best describes the primary difference between broadband and dial-up Internet connections?
Ans	✘ 1. Broadband is slower than dial-up.
	✔ 2. Dial-up uses a telephone line, while broadband uses various technologies for higher speeds.
	✘ 3. Broadband is only available in urban areas, while dial-up is available everywhere.
	✘ 4. Dial-up requires a cable connection, while broadband does not.

Question ID :	**6306801148419**
Option 1 ID :	**6306804513754**
Option 2 ID :	**6306804513755**
Option 3 ID :	**6306804513756**
Option 4 ID :	**6306804513757**
Status :	**Marked For Review**
Chosen Option :	**3**

Q.5	Which of the following keyboard shortcuts is commonly used to rename a file or folder in Windows OS?
Ans	✗ 1. Ctrl + F5
	✗ 2. Alt + Enter
	✗ 3. Ctrl + R
	✓ 4. F2

Question ID :	**6306801150227**
Option 1 ID :	**6306804520945**
Option 2 ID :	**6306804540988**
Option 3 ID :	**6306804520943**
Option 4 ID :	**6306804520944**
Status :	**Answered**
Chosen Option :	**4**

Q.6	What does QR in 'QR code' stand for?
Ans	✗ 1. Query Response
	✗ 2. Quantum Read
	✓ 3. Quick Response
	✗ 4. Quick Resolution

Question ID :	**6306801161059**
Option 1 ID :	**6306804563641**
Option 2 ID :	**6306804563642**
Option 3 ID :	**6306804563640**
Option 4 ID :	**6306804563639**
Status :	**Marked For Review**
Chosen Option :	**3**

Q.7	What application software is utilised for managing extensive data collections and executing queries?
Ans	✗ 1. Antivirus software
	✓ 2. Database management system software
	✗ 3. Word processing software
	✗ 4. Paint

Question ID :	**6306801147343**
Option 1 ID :	**6306804509503**
Option 2 ID :	**6306804509502**
Option 3 ID :	**6306804509501**
Option 4 ID :	**6306804550266**
Status :	**Answered**
Chosen Option :	**2**

Q.8	Which of the following is an essential role of ROM in a computer system?
Ans	✗ 1. Storing files created by the user
	✗ 2. Storing data temporarily
	✓ 3. Storing data permanently for boot-up processes
	✗ 4. Performing calculations

Question ID :	**6306801147330**
Option 1 ID :	**6306804509452**
Option 2 ID :	**6306804509449**
Option 3 ID :	**6306804509450**
Option 4 ID :	**6306804509451**
Status :	**Answered**
Chosen Option :	**3**

Q.9	Which browser extension could be used to download an entire web page for offline use?
Ans	✓ 1. Web ScrapBook
	✗ 2. AdBlock
	✗ 3. Evernote
	✗ 4. Grammarly

Question ID :	**6306801149589**
Option 1 ID :	**6306804518394**
Option 2 ID :	**6306804518393**
Option 3 ID :	**6306804518396**
Option 4 ID :	**6306804518395**
Status :	**Not Answered**
Chosen Option :	**--**

Q.10	How can using a smiley or emoji help reduce misunderstandings in instant messaging?
Ans	✗ 1. By shortening the message content
	✗ 2. By replacing words that could be misinterpreted
	✗ 3. By eliminating the need for a response
	✓ 4. By clarifying the sender's tone or emotional intent

Question ID :	**6306801160832**
Option 1 ID :	**6306804562739**
Option 2 ID :	**6306804562741**
Option 3 ID :	**6306804562742**
Option 4 ID :	**6306804562740**
Status :	**Answered**
Chosen Option :	**4**

Q.11	Which of the following protocols is commonly used for data encapsulation in WANs?
Ans	✔ 1. High-Level Data Link Control
	✘ 2. Wi-Fi
	✘ 3. Ethernet
	✘ 4. TCP/IP

Question ID :	**6306801158369**
Option 1 ID :	**6306804552783**
Option 2 ID :	**6306804552784**
Option 3 ID :	**6306804552782**
Option 4 ID :	**6306804552781**
Status :	**Marked For Review**
Chosen Option :	**4**

Q.12	What is the function of the CPU following the commencement of a DMA transfer?
Ans	✘ 1. It actively manages each byte transferred.
	✘ 2. It must remain idle until the DMA transfer is complete.
	✔ 3. It is free to perform other tasks while the transfer is handled by the DMA controller.
	✘ 4. It handles the entire data transfer.

Question ID :	**6306801147339**
Option 1 ID :	**6306804509485**
Option 2 ID :	**6306804509486**
Option 3 ID :	**6306804509487**
Option 4 ID :	**6306804509488**
Status :	**Not Answered**
Chosen Option :	**--**

Q.13	Which type of e-commerce model is exemplified by Amazon?
Ans	✔ 1. B2C (Business to Consumer)
	✘ 2. B2B (Business to Business)
	✘ 3. C2B (Consumer to Business)
	✘ 4. C2C (Consumer to Consumer)

Question ID :	**6306801160842**
Option 1 ID :	**6306804562781**
Option 2 ID :	**6306804562779**
Option 3 ID :	**6306804562782**
Option 4 ID :	**6306804562780**
Status :	**Answered**
Chosen Option :	**1**

Q.14	Keyboard shortcut to Save as document in MS Word 2019 is:
Ans	✗ 1. F9
	✗ 2. F11
	✗ 3. F10
	✓ 4. F12

Question ID :	**6306801157811**
Option 1 ID :	**6306804550384**
Option 2 ID :	**6306804550387**
Option 3 ID :	**6306804550385**
Option 4 ID :	**6306804550386**
Status :	**Answered**
Chosen Option :	**4**

Q.15	Which of the following is considered the first mechanical computer designed by Charles Babbage?
Ans	✗ 1. Abacus
	✗ 2. ENIAC
	✓ 3. Analytical Engine
	✗ 4. UNIVAC

Question ID :	**6306801152355**
Option 1 ID :	**6306804529394**
Option 2 ID :	**6306804529393**
Option 3 ID :	**6306804529395**
Option 4 ID :	**6306804529396**
Status :	**Answered**
Chosen Option :	**3**